Name: _____ Date: _____

# Decimal Number Line Placement

Look at each number line. Use the given information to place the decimals or write the decimals for the marked points.

**1.** Mark the given decimals on the number line.

0.3 0.7 1.2 1.6 1.9

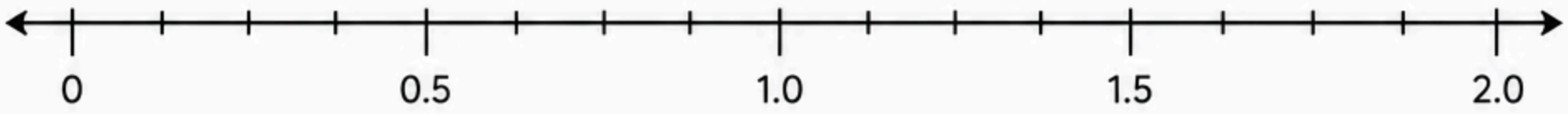


**2.** Write the decimal shown by each marked point.

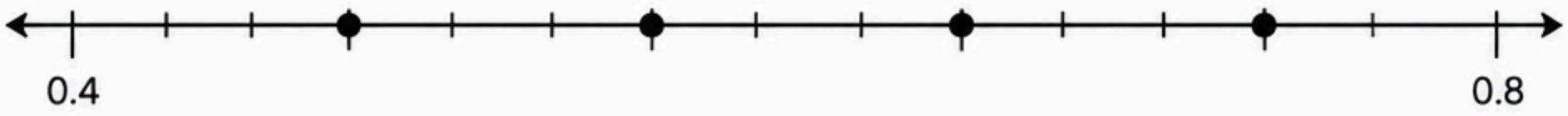


_____ _____ _____ _____

**3.** Mark the given decimals on the number line.

2.4 2.75 3.1 3.6 3.9

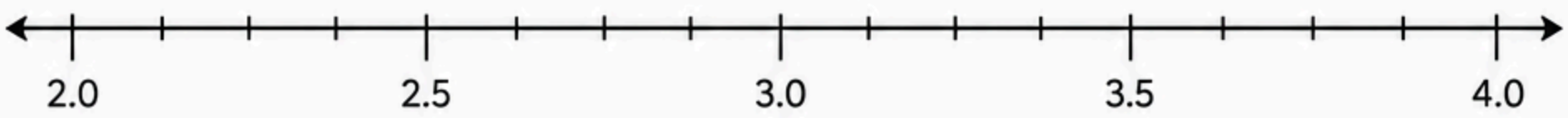


**4.** Write the decimal shown by each marked point.

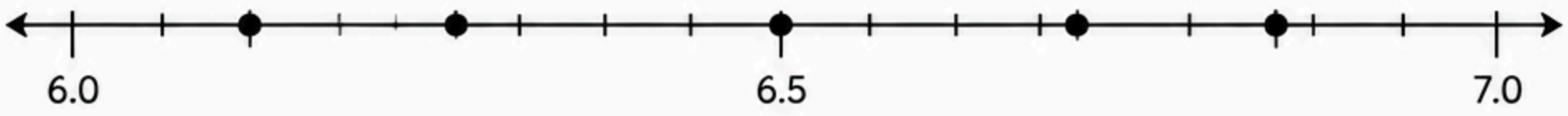


_____ _____ _____ _____ _____

**5.** Place the decimals in order from smallest to largest on the number line.

5.8 5.2 5.45 5.9 5.35

