Reading Scales and Measuring Instruments

Measurement – Year 6

Name: _____ **Date:** _____

1. Rulers

Look at each ruler and read the measurement shown by the object. Write the length in the units stated.

a) Length of the pencil (cm)

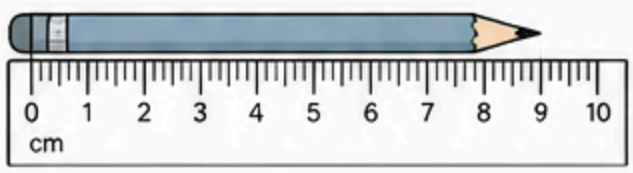

_____ cm

b) Length of the paper clip (mm)

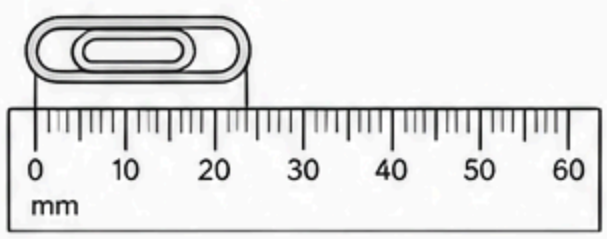

_____ mm

c) Length of the piece of string (cm)

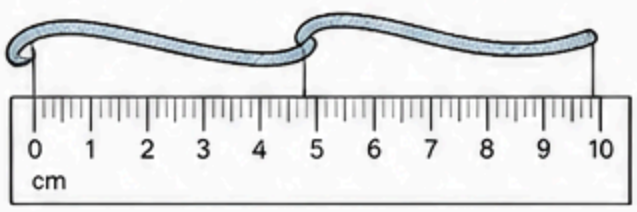

_____ cm

2. Measuring Jugs

Read the volume of liquid in each measuring jug.

a)

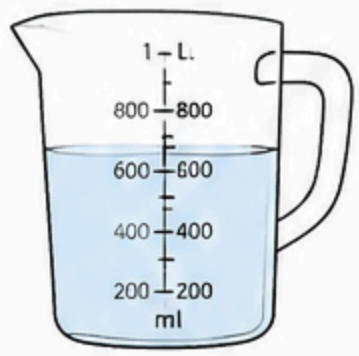

_____ ml

b)

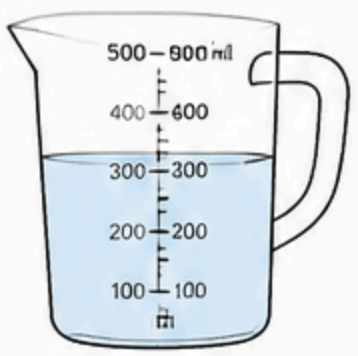

_____ ml

c)

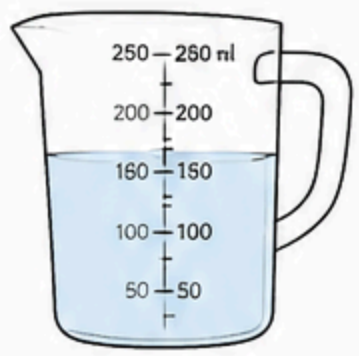

_____ ml

d)



_____ ml

3. Thermometers

Read the temperature shown on each thermometer.

a)

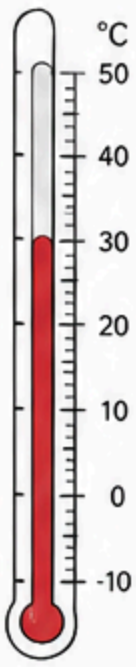

_____ °C

b)

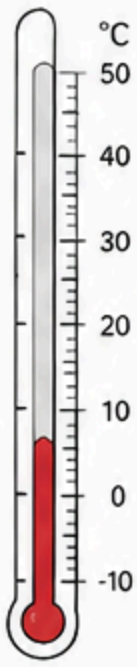

_____ °C

c)

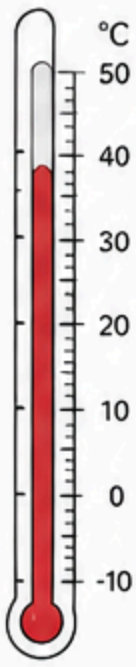

_____ °C

4. Weighing Scales

Read the mass shown on each weighing scale.

a)



_____ kg

b)



_____ kg

c)



_____ g

d)



_____ g

5. Mixed Practice

Write the measurement shown in the units requested.

a) 3.5 L = _____ ml

b) 4200 g = _____ kg

c) 6.8 m = _____ cm

d) 90 mm = _____ cm