Name: _____ Date: _____

Shade the Fraction Shapes

Colour or shade the parts of each shape to show the given fraction.

1. Shade the shapes to show $\frac{1}{2}$.



$\frac{1}{2}$



$\frac{1}{2}$



$\frac{1}{2}$

2. Shade the shapes to show $\frac{1}{4}$.



$\frac{1}{4}$



$\frac{1}{4}$

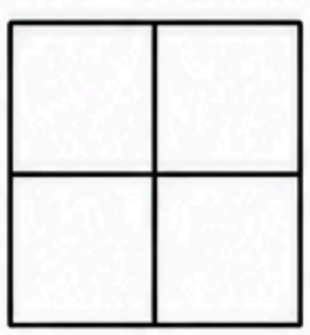

$\frac{1}{4}$

3. Shade the shapes to show $\frac{3}{4}$.



$\frac{3}{4}$



$\frac{3}{4}$

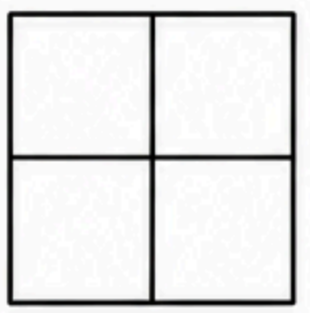

$\frac{3}{4}$

4. Shade the shapes to show $\frac{1}{3}$.



$\frac{1}{3}$



$\frac{1}{3}$

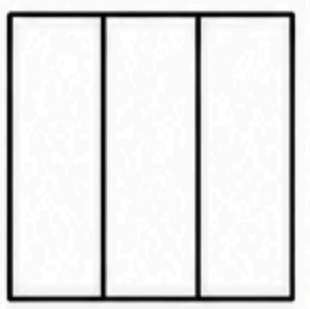

$\frac{1}{3}$