Name: _____ Date: _____

Shade Decimals on Grid Models

Shade the grid squares to represent the decimal number.
Then write the matching decimal notation under the grid.



A 10 × 10 grid has 100 squares.
Each square represents **0.01**
(one hundredth).

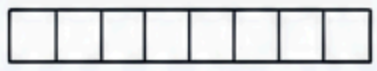

A 1 × 10 grid has 10 squares.
Each square represents **0.1**
(one tenth).

1. Shade 3 tenths.

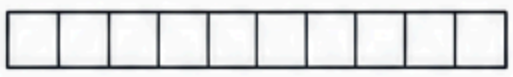

_____

2. Shade 7 tenths.

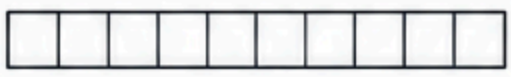

_____

3. Shade 25 hundredths.



_____

4. Shade 6 tenths.



_____

5. Shade 48 hundredths.



_____

6. Shade 9 tenths.



_____

7. Shade 12 hundredths.



_____

8. Shade 5 tenths.

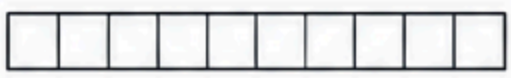

_____

9. Shade 63 hundredths.



_____