Name: _____ Date: _____

Picture Subtraction: Cross Out and Count

Cross out the pictures to subtract. Then count how many are left. Write your answer in the box.

1 7 − 3 =



□ are left

2 6 − 2 =



□ are left

3 5 − 1 =



□ are left

4 8 − 4 =



□ are left

5 9 − 5 =

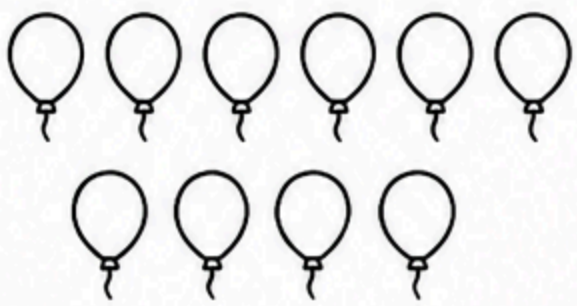

□ are left

6 4 − 2 =



□ are left

7 10 − 6 =



□ are left

8 3 − 1 =



□ are left