Name: _____ Date: _____

Measuring Objects with a Ruler

Use the ruler below to measure the length of each object in centimetres (cm).
Write your answer in the space provided.



1. Measure the length of the pencil.



_____ cm

2. Measure the length of the ruler (small).



_____ cm

3. Measure the length of the book.



_____ cm

4. Measure the length of the spoon.



_____ cm

5. Measure the length of the paperclip.

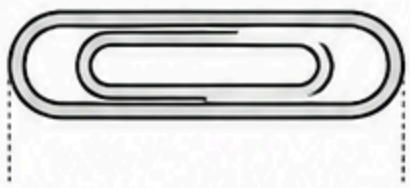

_____ cm

6. Measure the length of the marker.



_____ cm

7. Measure the length of the leaf.

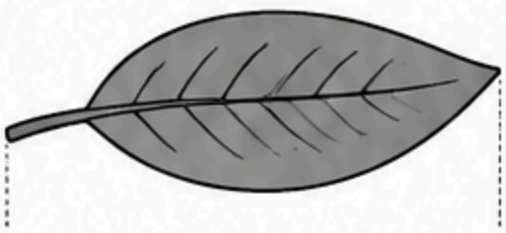

_____ cm

8. Measure the length of the ruler (large).



_____ cm