Name: _____ Date: _____

Picture Groups Multiplication

Count the objects in each group and write the matching multiplication equation.

1.



□ × □ = □

2.



□ × □ = □

3.



□ × □ = □

4.



□ × □ = □

5.



□ × □ = □

6.



□ × □ = □