Name: _____ Date: _____

Count and Add Picture Groups

Count the objects in each group. Write the addition number sentence to find the total.

1.





_____ + _____ = _____ + _____ = ☐

2.





_____ + _____ = _____ + _____ = ☐

3.



_____ + _____ = _____ + _____ = ☐

4.





_____ + _____ = _____ + _____ = ☐

5.





_____ + _____ = _____ + _____ = ☐