Name: _____ Date: _____

Shade the Fraction - Visual Models

Shade the given fraction of each shape. Use neat, accurate shading.

1. Circles – Shade the fraction.

a) 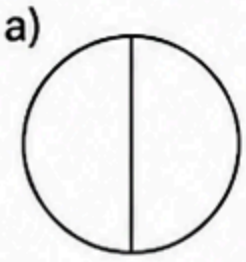

$\frac{1}{2}$

b) 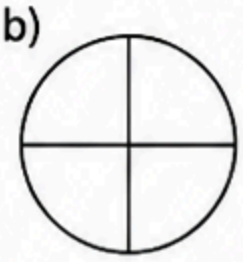

$\frac{1}{4}$

c) 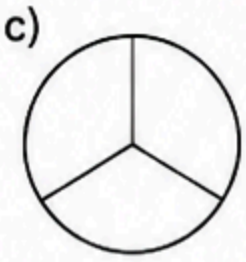

$\frac{2}{3}$

d) 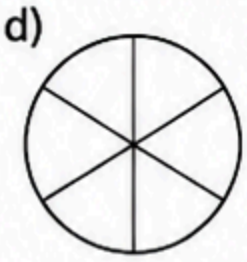

$\frac{3}{6}$

e) 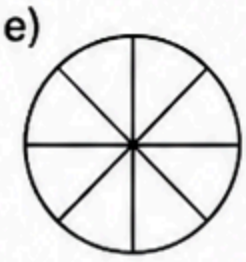

$\frac{5}{8}$

f) 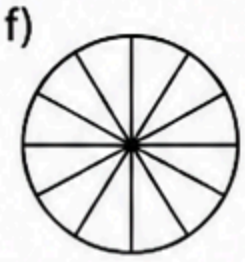

$\frac{3}{10}$

---

2. Rectangles – Shade the fraction.

a)

$\frac{1}{2}$

b)

$\frac{1}{4}$

c)

$\frac{2}{5}$

d) 

$\frac{2}{6}$

e) 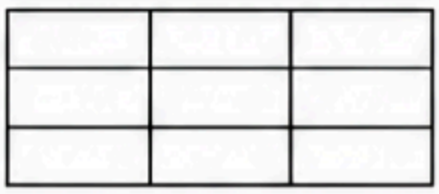

$\frac{5}{12}$

f)

$\frac{3}{10}$

---

3. Squares – Shade the fraction.

a) 

$\frac{1}{2}$

b) 

$\frac{3}{4}$

c)

$\frac{2}{3}$

d) 

$\frac{4}{9}$

e) 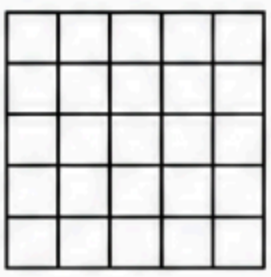

$\frac{5}{16}$

f) 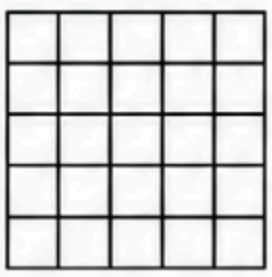

$\frac{7}{25}$