Name: _____ Date: _____

Reading Scales and Measuring Instruments

Measurement – Year 6

Read each scale carefully. Write your answer in the correct unit.

1. Rulers – What is the length of each line?

a)

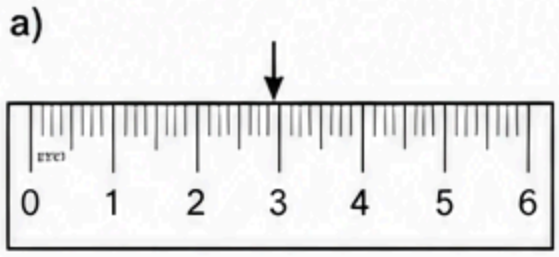

_____ cm

b)

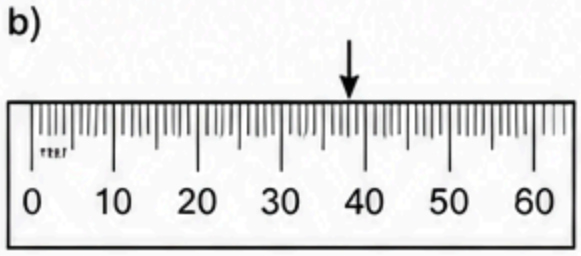

_____ mm

c)

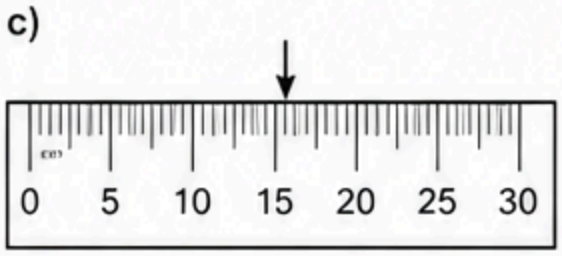

_____ cm

2. Measuring jugs – What is the volume of the liquid?

a)

_____ mL

b)

_____ L

c)

_____ mL

3. Thermometers – What is the temperature?

a)

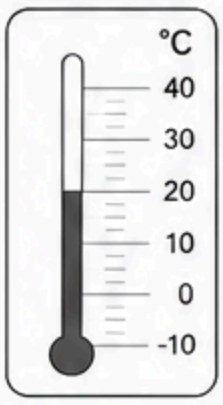

_____ °C

b)

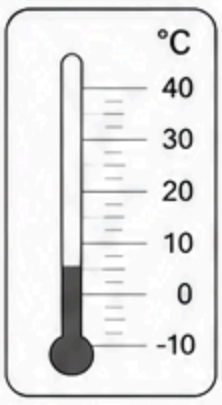

_____ °C

c)

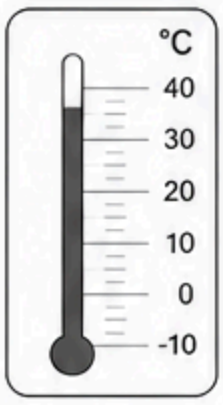

_____ °C

4. Weighing scales – What is the mass shown?

a)

_____ g

b)

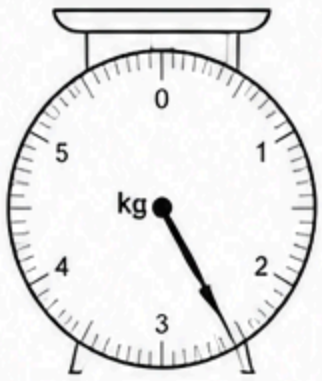

_____ kg

c)



_____ kg

5. Protractors – What is the size of each angle?

a)

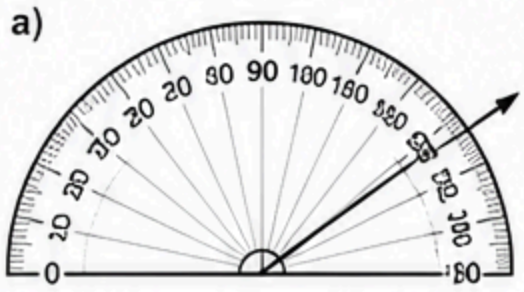

_____ °

b)

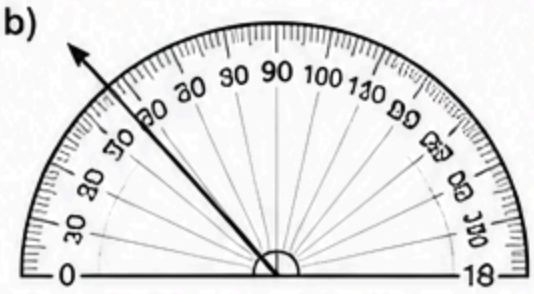

_____ °

c)

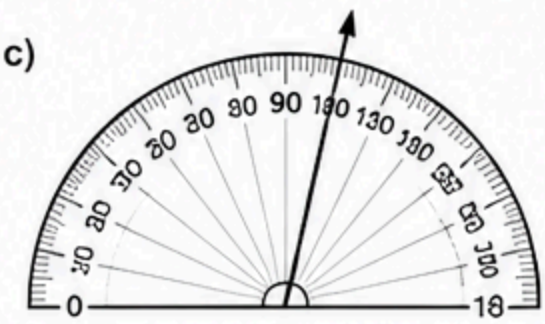

_____ °