Measurement – Year 5

Reading Scales and Measuring Instruments

Name: _____ Date: _____

1. Read each ruler. Write the length of the object in centimetres (cm).

a)

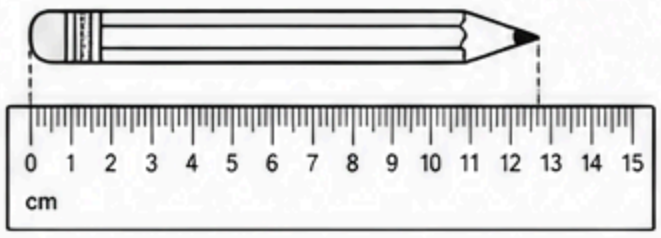

_____ cm

b)

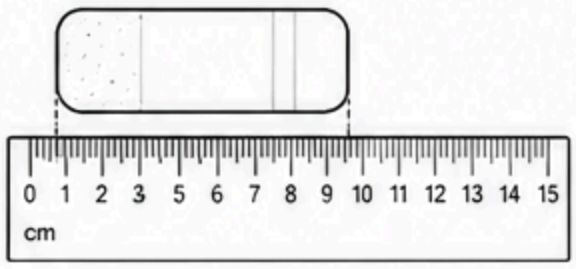

_____ cm

c)

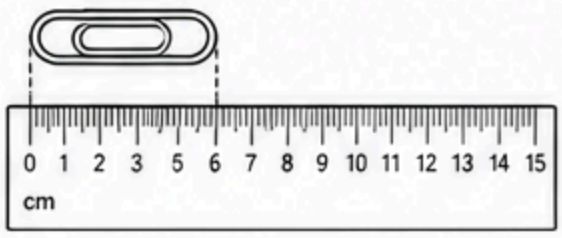

_____ cm

2. Read each thermometer. Write the temperature in degrees Celsius (°C).

a)



_____ °C

b)

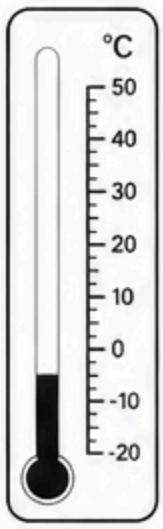

_____ °C

c)



_____ °C

d)

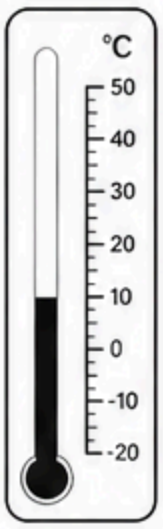

_____ °C

3. Read each measuring jug. Write the volume in millilitres (mL).

a)

_____ mL

b)

_____ mL

c)

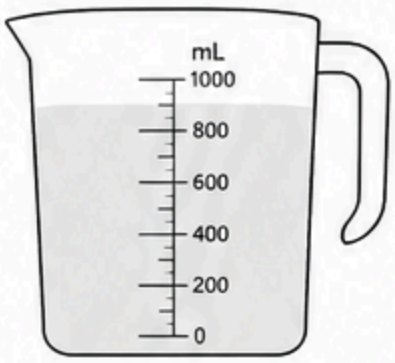

_____ mL

4. Read each scale. Write the mass in grams (g) or kilograms (kg).

a)

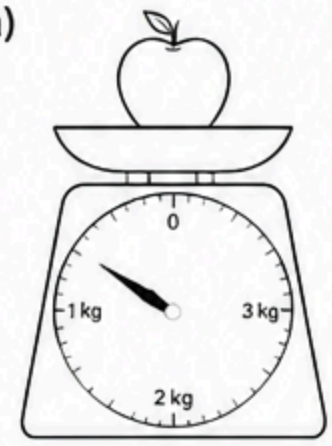

_____ kg

b)

_____ kg

c)

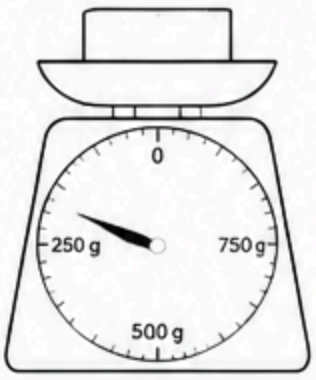

_____ g

d)

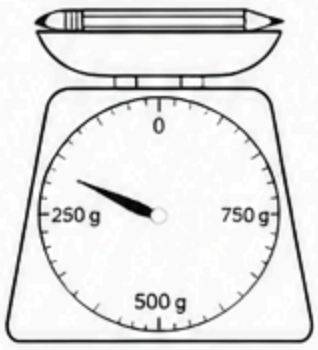

_____ g